Name:

Find the perimeter

1.

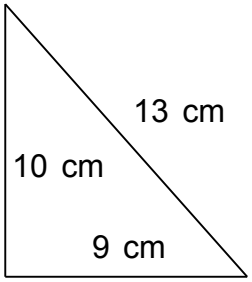

P =32 cm

2.

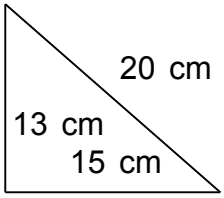

P =48 cm

3.

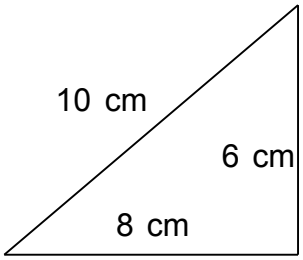

P =24 cm

4.

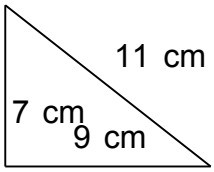

P =27 cm

5.

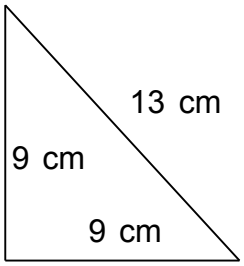

P =31 cm

6.

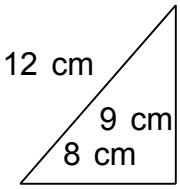

P =29 cm

7.

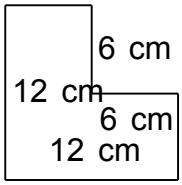

P =48 cm

8.

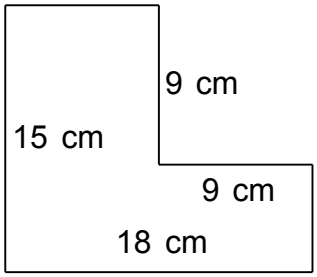

P =66 cm

9.

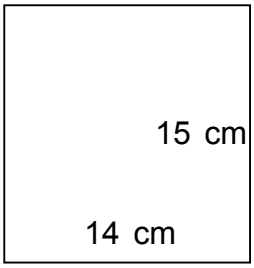

P =58 cm

10.

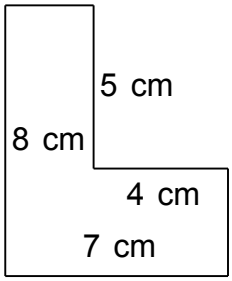

P =30 cm

11.

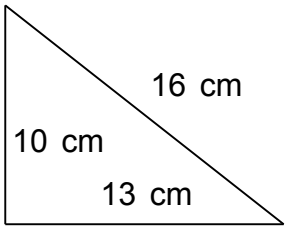

P =39 cm

12.

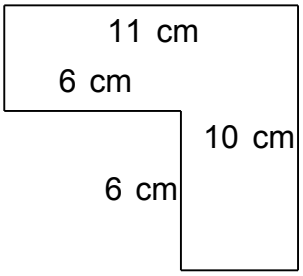

P =42 cm

13.

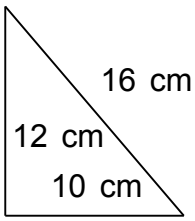

P =38 cm

14.

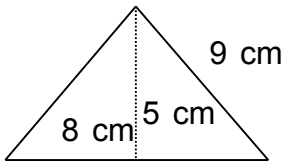

P =26 cm

15.

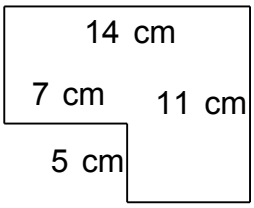

P =50 cm